Expanding Fractions



Find each equivalent fraction by multiplying the numerator and denominator by same number. Then color the correct number of boxes.

$\frac{1}{5} \times \frac{2}{2} = \frac{2}{10}$

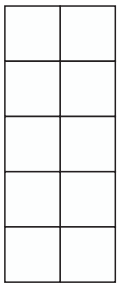

$\frac{1}{3} = \frac{\quad}{\quad}$

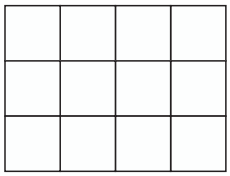

$\frac{3}{4} = \frac{\quad}{\quad}$

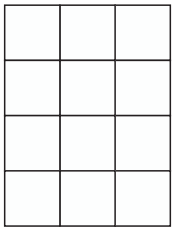

$\frac{3}{4} = \frac{\quad}{\quad}$

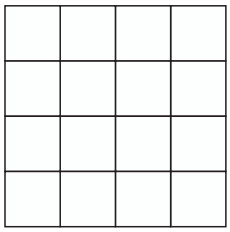

$\frac{2}{3} = \frac{\quad}{\quad}$

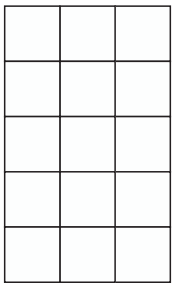

$\frac{1}{3} = \frac{\quad}{\quad}$

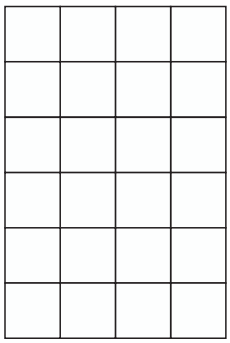

$\frac{2}{5} = \frac{\quad}{\quad}$

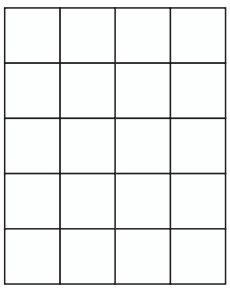

$\frac{1}{4} = \frac{\quad}{\quad}$

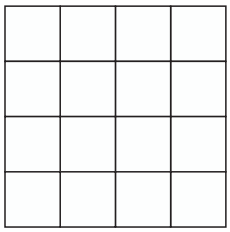

Math Online School

Expanding Fractions

Find each equivalent fraction by multiplying the numerator and denominator by same number. Then color the correct number of boxes.

$\frac{1 \times 2}{5 \times 2} = \frac{2}{10}$

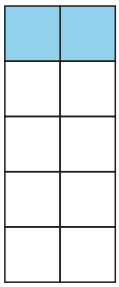

$\frac{1 \times 4}{3 \times 4} = \frac{4}{12}$

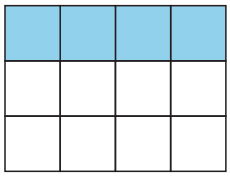

$\frac{3 \times 3}{4 \times 3} = \frac{9}{12}$

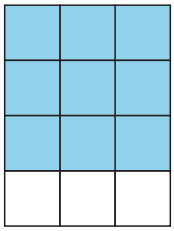

$\frac{3 \times 4}{4 \times 4} = \frac{12}{16}$

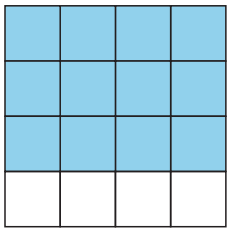

$\frac{2 \times 5}{3 \times 5} = \frac{10}{15}$

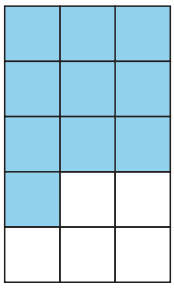

$\frac{1 \times 8}{3 \times 8} = \frac{8}{24}$

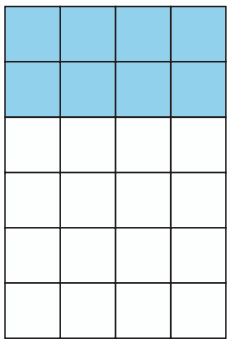

$\frac{2 \times 4}{5 \times 4} = \frac{8}{20}$

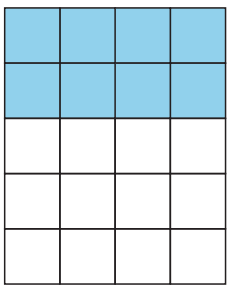

$\frac{1 \times 4}{4 \times 4} = \frac{4}{16}$

