3D Shapes

Which 3D shape do you see? Write its name.

(cone, sphere, cube, rectangular prism, pyramid, cylinder)



















3D Shapes

Which 3D shape do you see? Write its name.

(cone, sphere, cube, rectangular prism, pyramid, cylinder, prism)



cube



rectangular prism



sphere



cylinder



prism



pyramid



cone



cube



prism