Metric Units of Weight: Kilograms and Grams



How much does the sphere weigh?

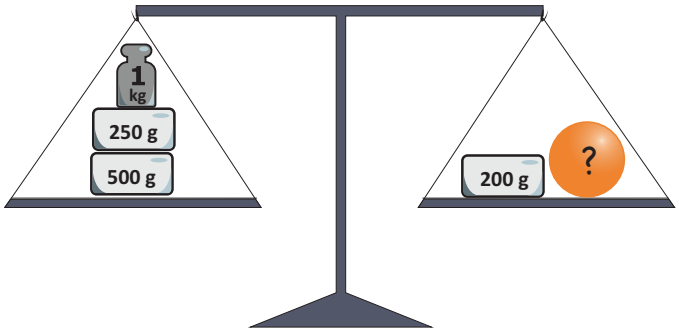

The sphere weighs ☐ kg ☐ g.

The sphere weighs ☐ kg ☐ g.

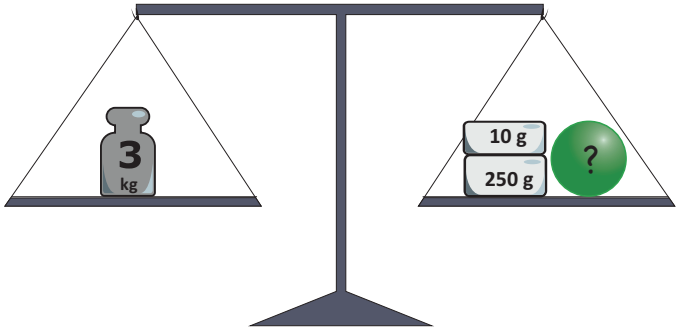

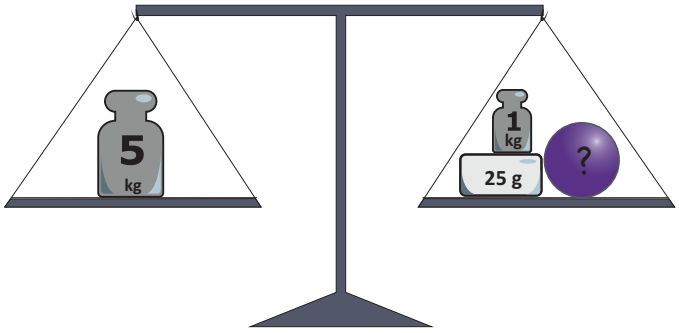

The sphere weighs ☐ kg ☐ g.

Math Online School

Metric Units of Weight: Kilograms and Grams



How much does the sphere weigh?

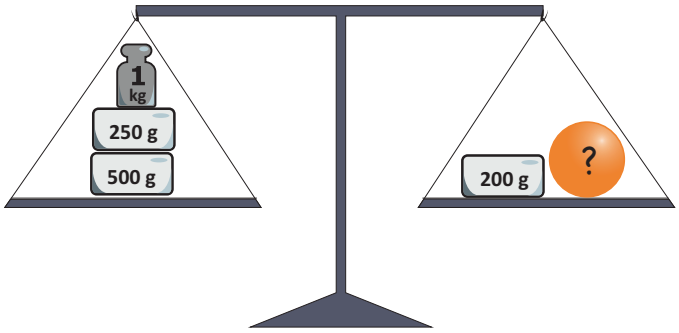

1 kg = 1000 g

1000 g + 250 g + 500 g = 1750 g

1750 g - 200 g = 1550 g

The sphere weighs 1 kg 550 g.

3kg = 3000 g

3000 g - 250 g - 10 g = 2740 g

The sphere weighs 2 kg 740 g.

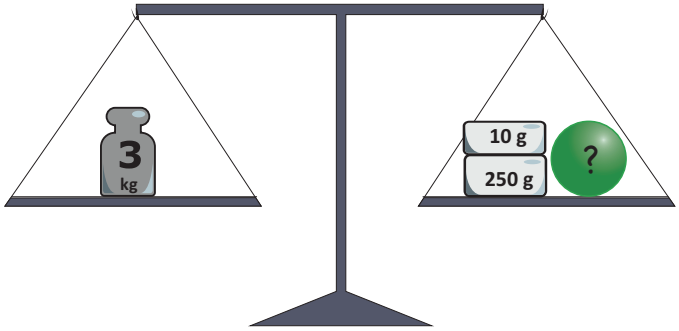

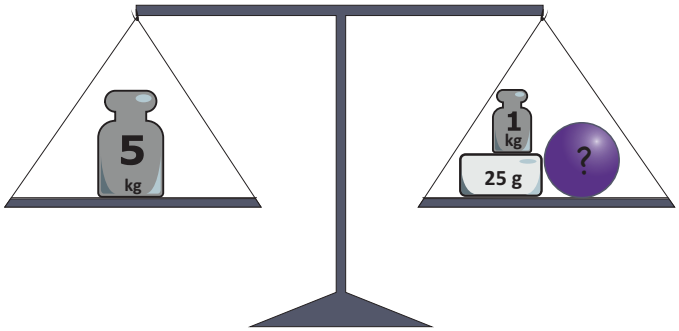

5 kg = 5000 g 1 kg = 1000 g

5000 g - 1000 g - 25 g = 3975 g

The sphere weighs 3 kg 975 g.