Math Online School

Cube Structures and Their Floor Plans

Study the cube structure. The floor plan shows the structure from above. Write the number of cubes stacked on each square of the floor plan.

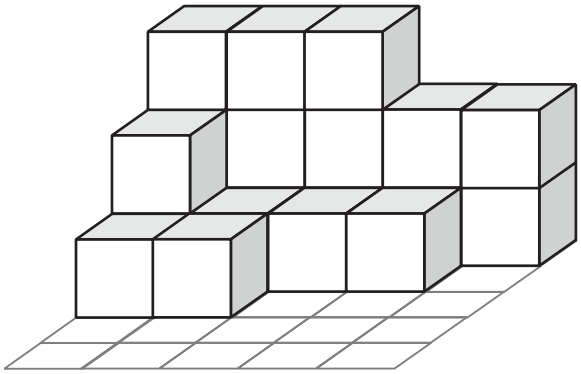

3	3	3	2	
2				

Total number of cubes: _____

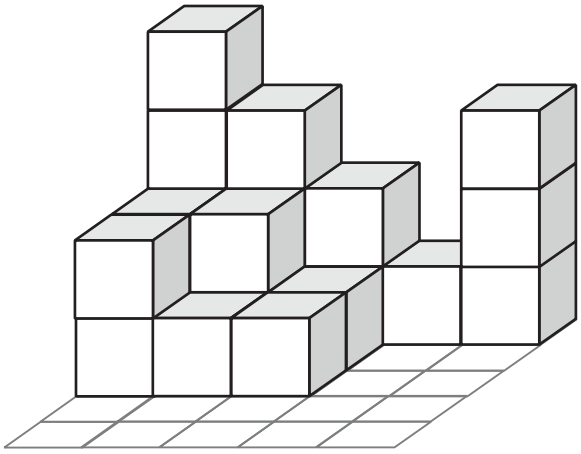

Total number of cubes: _____

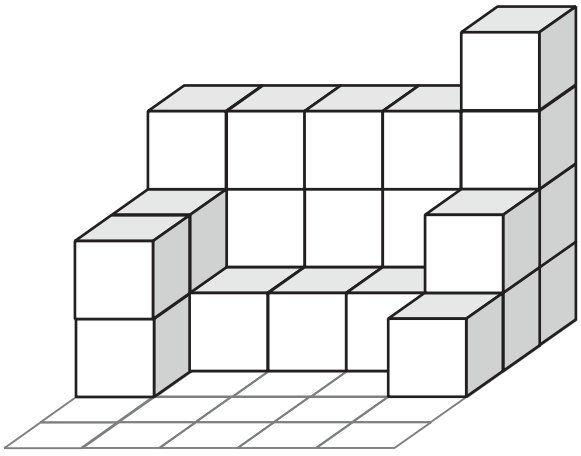

Total number of cubes: _____

Math Online School

Cube Structures and Their Floor Plans

Study the cube structure. The floor plan shows the structure from above. Write the number of cubes stacked on each square of the floor plan.

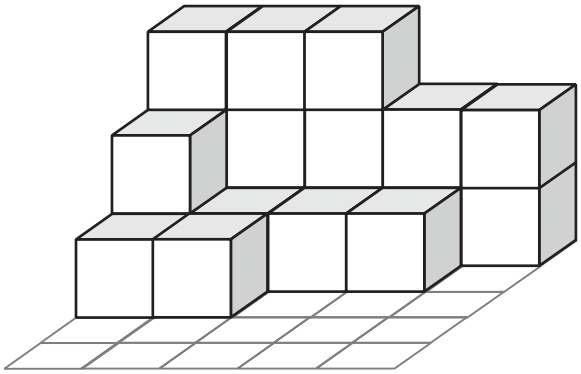

3	3	3	2	2
2	1	1	1	
1	1			

Total number of cubes: 20

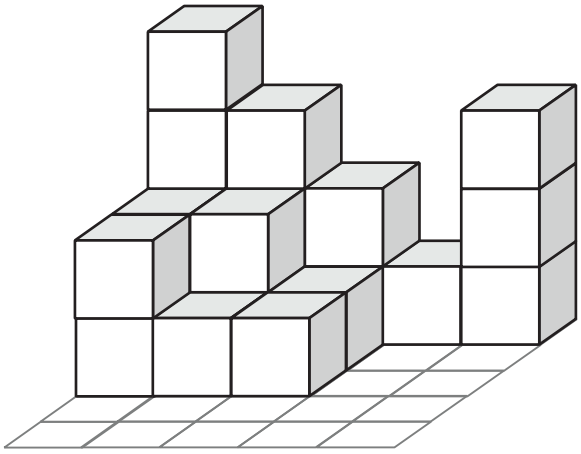

4	3	2	1	3
2	2	1		
2	1	1		

Total number of cubes: 22

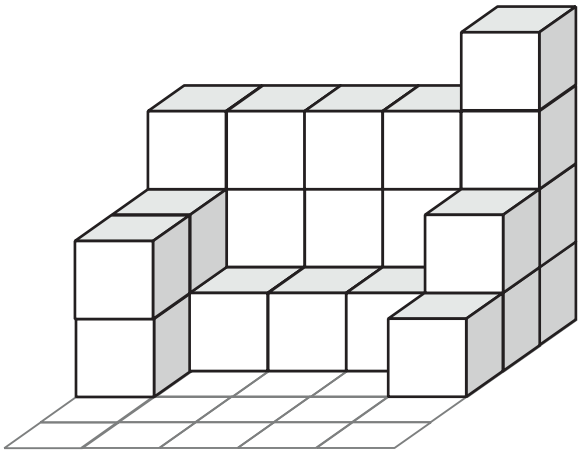

3	3	3	3	4
2	1	1	1	2
2				1

Total number of cubes: 26