Math Online School

Showing Fractions

What fraction of the whole is shaded? Write each as a fraction!





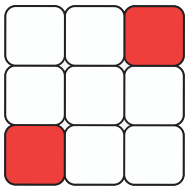



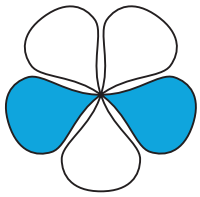



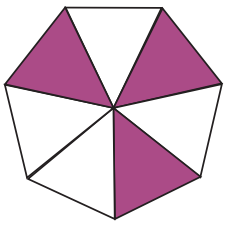

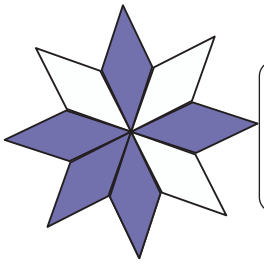

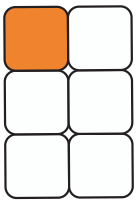

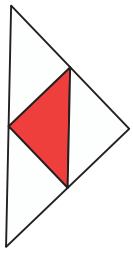

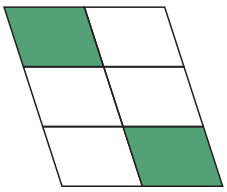



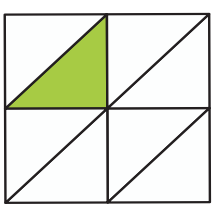

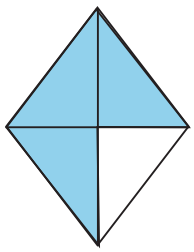

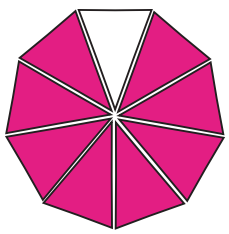

Math Online School

Showing Fractions



What fraction of the whole is shaded? Write each as a fraction!



$\frac{4}{10}$



$\frac{1}{4}$

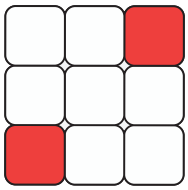

$\frac{2}{9}$



$\frac{5}{9}$

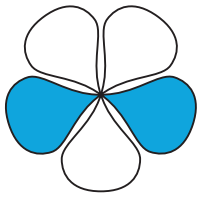

$\frac{2}{5}$



$\frac{3}{8}$

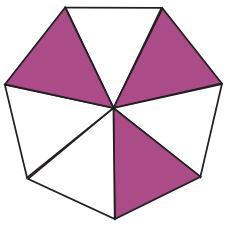

$\frac{3}{7}$

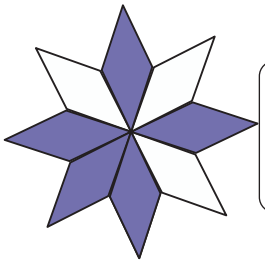

$\frac{5}{8}$

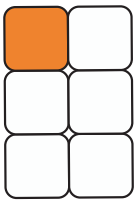

$\frac{1}{6}$

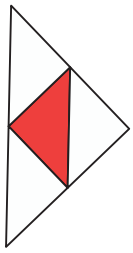

$\frac{1}{4}$

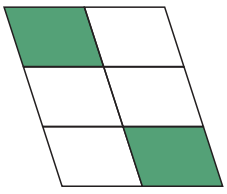

$\frac{2}{6}$



$\frac{4}{12}$

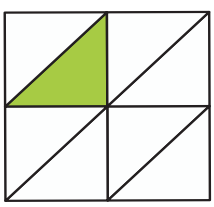

$\frac{1}{8}$

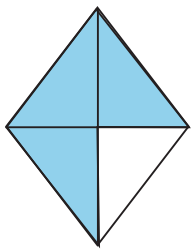

$\frac{3}{4}$

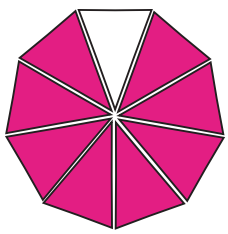

$\frac{8}{9}$