Showing Fractions



Look at each fraction. Divide the rectangle into the correct number of equal parts, then color in the number of parts shown.



$\frac{1}{3}$



$\frac{2}{4}$



$\frac{5}{6}$



$\frac{3}{8}$



$\frac{1}{2}$



$\frac{7}{12}$

Math Online School

Showing Fractions



Look at each fraction. Divide the rectangle into the correct number of equal parts, then color in the number of parts shown.



$\frac{1}{3}$

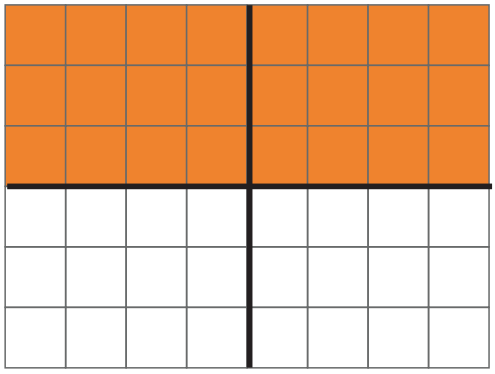

$\frac{2}{4}$

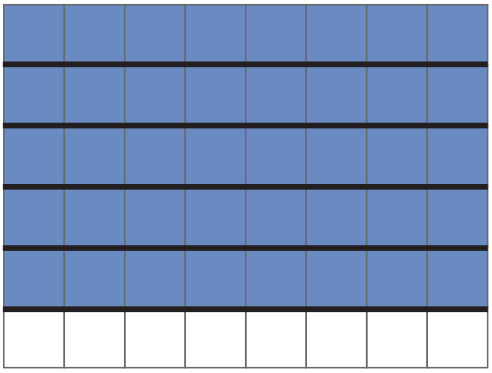

$\frac{5}{6}$

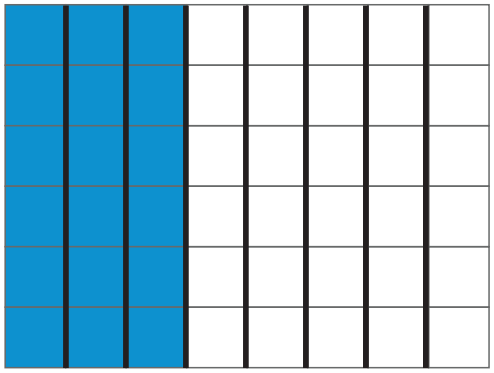

$\frac{3}{8}$

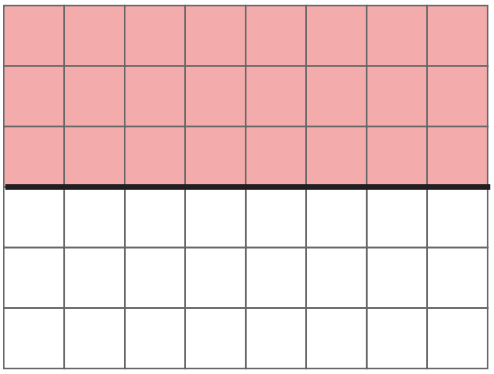

$\frac{1}{2}$

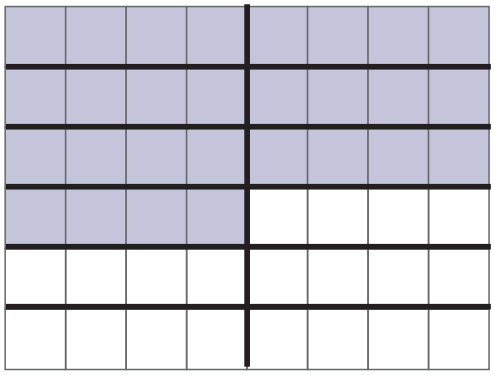

$\frac{7}{12}$