Math Online School

Showing Fractions



What fraction of the whole is shaded? Mark the correct answer.

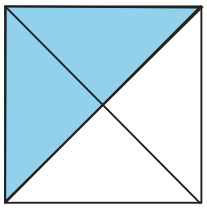

- ☐ two eighths
- ☐ one half
- ☑ two quarters

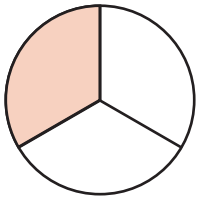

- ☐ one third
- ☐ one fifth
- ☐ one half



- ☐ two thirds
- ☐ two sixths
- ☐ three quarters

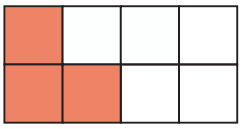

- ☐ eight thirds
- ☐ three eighths
- ☐ three quarters

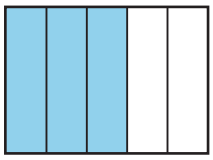

- ☐ five thirds
- ☐ three quarters
- ☐ three fifths

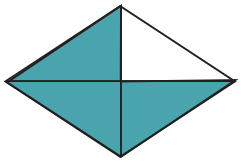

- ☐ three fifths
- ☐ two sixths
- ☐ three quarters

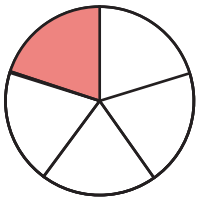

- ☐ one fifth
- ☐ one third
- ☐ one eighth

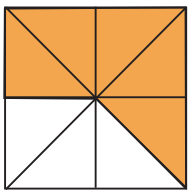

- ☐ three fifths
- ☐ five thirds
- ☐ five eighths

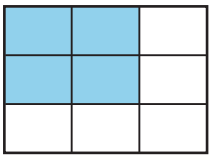

- ☐ four sixths
- ☐ two thirds
- ☐ four ninths



- ☐ one third
- ☐ one half
- ☐ a whole

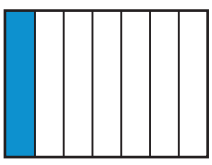

- ☐ one sixth
- ☐ one half
- ☐ a whole



- ☐ three tenths
- ☐ three quarters
- ☐ two sevenths

Math Online School

Showing Fractions



What fraction of the whole is shaded? Mark the correct answer.

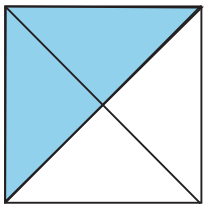

- [ ] two eighths
- [ ] one half
- [x] two quarters

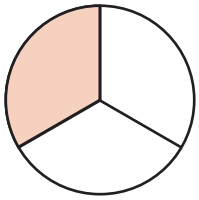

- [x] one third
- [ ] one fifth
- [ ] one half



- [ ] two thirds
- [x] two sixths
- [ ] three quarters

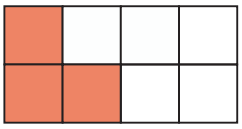

- [ ] eight thirds
- [x] three eighths
- [ ] three quarters

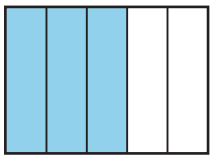

- [ ] five thirds
- [ ] three quarters
- [x] three fifths

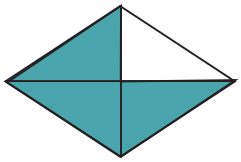

- [ ] three fifths
- [ ] two sixths
- [x] three quarters

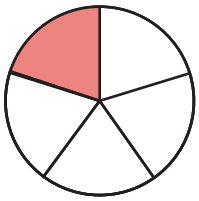

- [x] one fifth
- [ ] one third
- [ ] one eighth

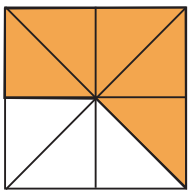

- [ ] three fifths
- [ ] five thirds
- [x] five eighths

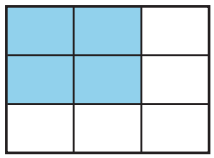

- [ ] four sixths
- [ ] two thirds
- [x] four ninths



- [ ] one third
- [x] one half
- [ ] a whole

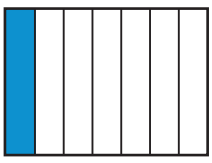

- [x] one sixth
- [ ] one half
- [ ] a whole



- [x] three tenths
- [ ] three quarters
- [ ] two sevenths