Simplifying Fractions



Simplify each fraction using the indicated number. Then draw a line to match each fraction to its equivalent fraction.

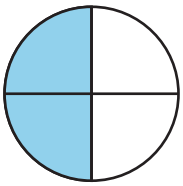

$\frac{2 \div 2}{4 \div 2} = \frac{1}{2}$

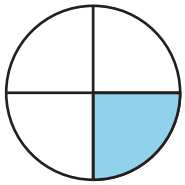

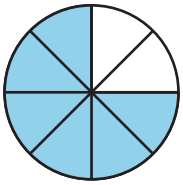

$\frac{6 \div 2}{8 \div 2} = \frac{\quad}{\quad}$

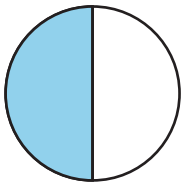

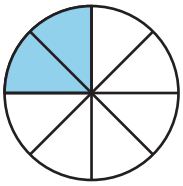

$\frac{2 \div 2}{8 \div 2} = \frac{\quad}{\quad}$

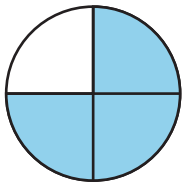

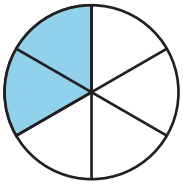

$\frac{2 \div 2}{6 \div 2} = \frac{\quad}{\quad}$

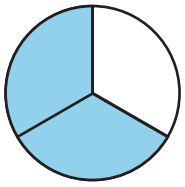

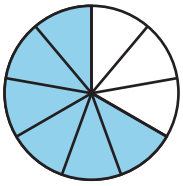

$\frac{6 \div 3}{9 \div 3} = \frac{\quad}{\quad}$



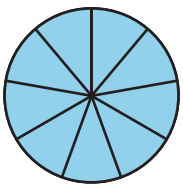

$\frac{9 \div 9}{9 \div 9} = \frac{\quad}{\quad}$

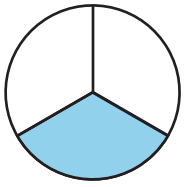

Simplifying Fractions



Simplify each fraction using the indicated number. Then draw a line to match each fraction to its equivalent fraction.

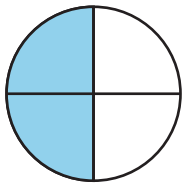

$\frac{2 \div 2}{4 \div 2} = \frac{1}{2}$

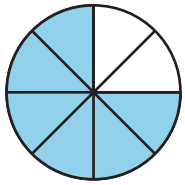

$\frac{6 \div 2}{8 \div 2} = \frac{3}{4}$

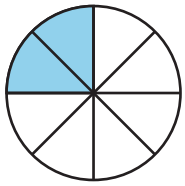

$\frac{2 \div 2}{8 \div 2} = \frac{1}{4}$

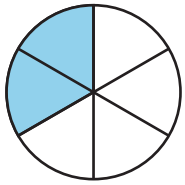

$\frac{2 \div 2}{6 \div 2} = \frac{1}{3}$

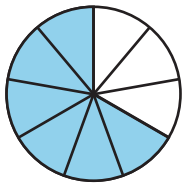

$\frac{6 \div 3}{9 \div 3} = \frac{2}{3}$

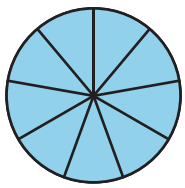

$\frac{9 \div 9}{9 \div 9} = \frac{1}{1}$

