Math Online School

Expanding Fractions

Find each equivalent fraction by multiplying the numerator and denominator by the given number. Then draw a line to match each fraction to its equivalent fraction.

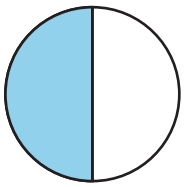

$\frac{1 \times 2}{2 \times 2} = \frac{\quad}{\quad}$

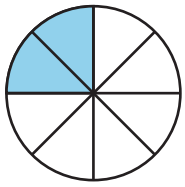

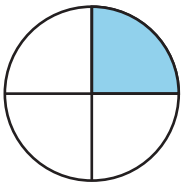

$\frac{1 \times 2}{4 \times 2} = \frac{\quad}{\quad}$

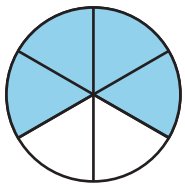

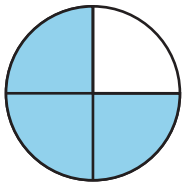

$\frac{3 \times 2}{4 \times 2} = \frac{\quad}{\quad}$

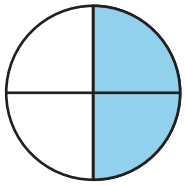



$\frac{2 \times 2}{3 \times 2} = \frac{\quad}{\quad}$

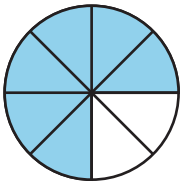

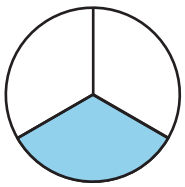

$\frac{1 \times 3}{3 \times 3} = \frac{\quad}{\quad}$

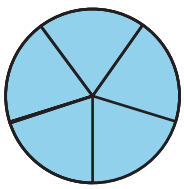



$\frac{1 \times 5}{1 \times 5} = \frac{\quad}{\quad}$



Expanding Fractions

Find each equivalent fraction by multiplying the numerator and denominator by the given number. Then draw a line to match each fraction to its equivalent fraction.

