Math Online School

Fractions on a Number Line

Place each fraction on the appropriate number line.

$\frac{5}{8}$ $\frac{3}{4}$ $\frac{2}{5}$ $\frac{5}{6}$ $\frac{1}{3}$ $\frac{4}{7}$

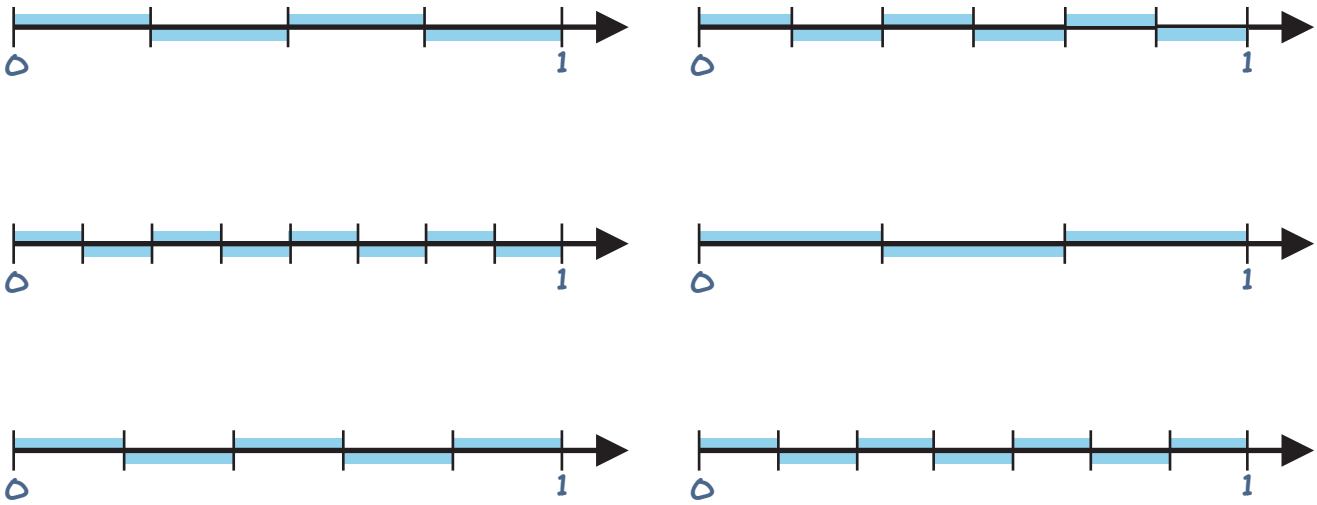

First, write each improper fraction as a mixed number. Then place it on the number line.

$\frac{8}{5} =$ $\frac{11}{3} =$ $\frac{17}{4} =$ $\frac{17}{6} =$

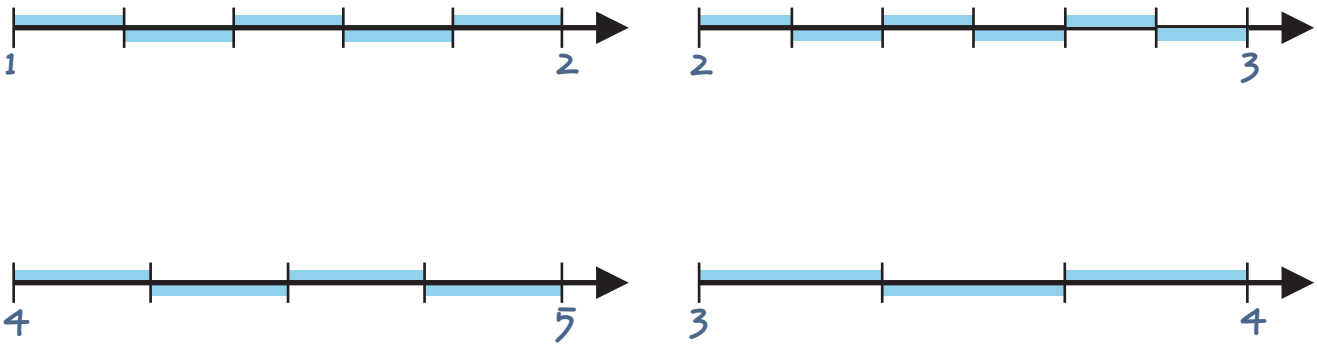

Math Online School

Fractions on a Number Line

Place each fraction on the appropriate number line.

$\frac{5}{8}$ $\frac{3}{4}$ $\frac{2}{5}$ $\frac{5}{6}$ $\frac{1}{3}$ $\frac{4}{7}$

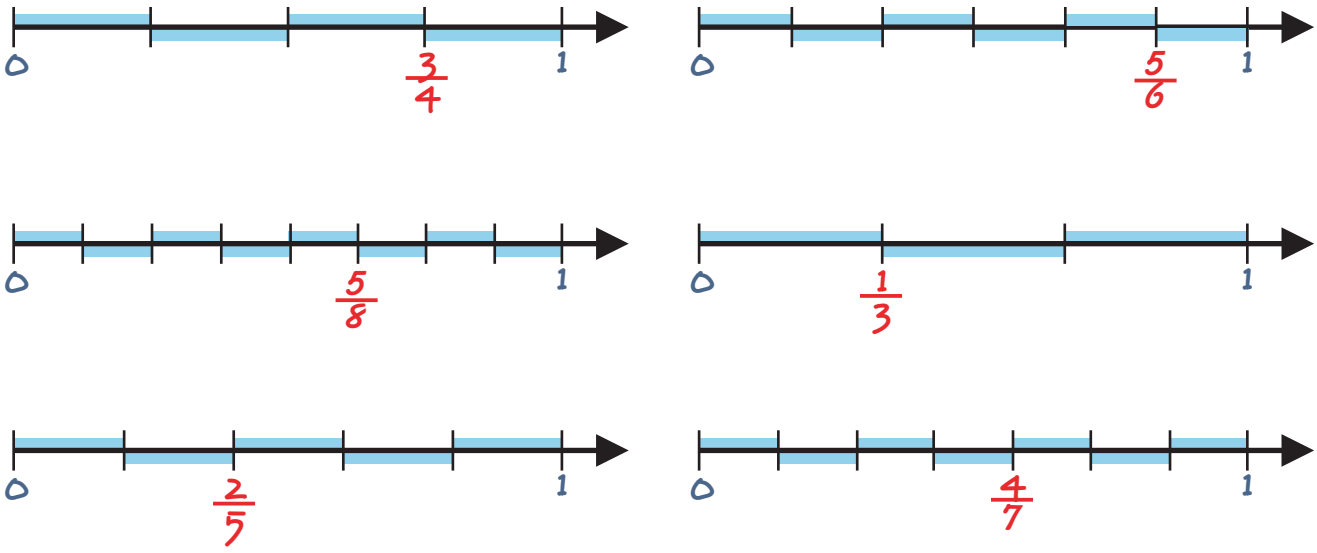

First, write each improper fraction as a mixed number. Then place it on the number line.

$\frac{8}{5} = 1\frac{3}{5}$ $\frac{11}{3} = 3\frac{2}{3}$ $\frac{17}{4} = 4\frac{1}{4}$ $\frac{17}{6} = 2\frac{5}{6}$

