Mixed Numbers and Improper Fractions

Which mixed number is shown?

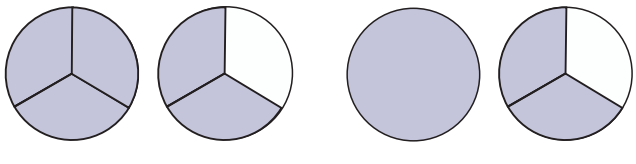

$\frac{3}{3} + \frac{2}{3} = 1 + \frac{2}{3} = 1\frac{2}{3}$

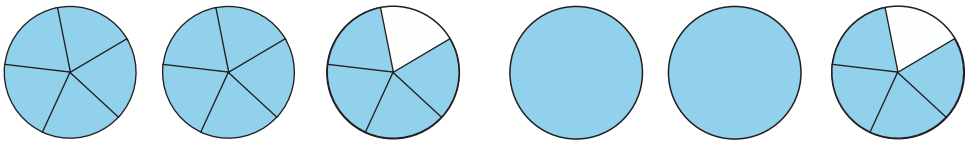

___ + ___ + ___ = ☐ + ☐ + ___ = ___

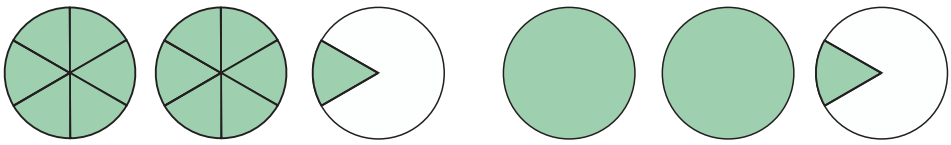

___ + ___ + ___ = ☐ + ☐ + ___ = ___

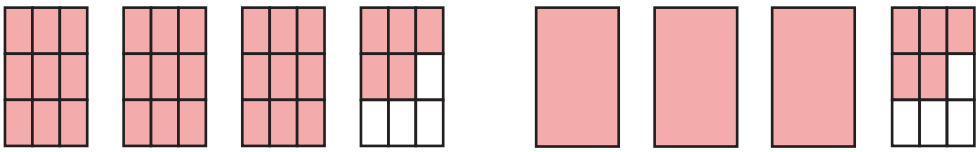

___ + ___ + ___ + ___ = ☐ + ☐ + ☐ + ___ = ___



___ + ___ = ☐ + ___ = ___

Mixed Numbers and Improper Fractions

Which mixed number is shown?

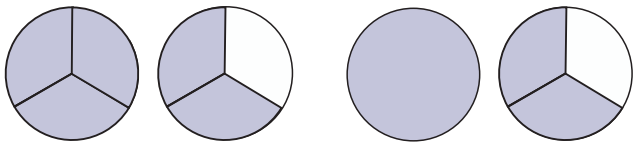

$\frac{3}{3} + \frac{2}{3} = 1 + \frac{2}{3} = 1\frac{2}{3}$

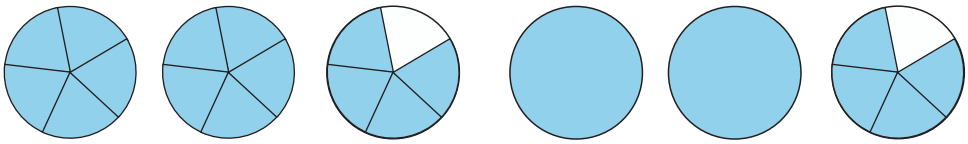

$\frac{5}{5} + \frac{5}{5} + \frac{4}{5} = 1 + 1 + \frac{4}{5} = 2\frac{4}{5}$

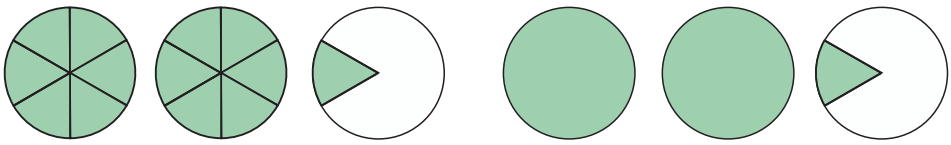

$\frac{6}{6} + \frac{6}{6} + \frac{1}{6} = 1 + 1 + \frac{1}{6} = 2\frac{1}{6}$

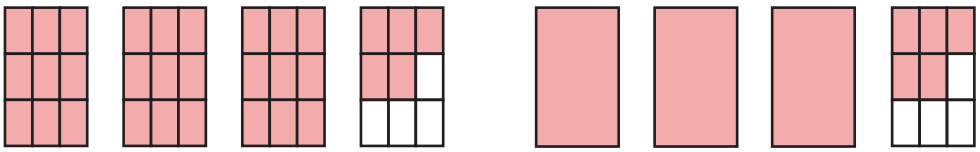

$\frac{9}{9} + \frac{9}{9} + \frac{9}{9} + \frac{5}{9} = 1 + 1 + 1 + \frac{5}{9} = 3\frac{5}{9}$

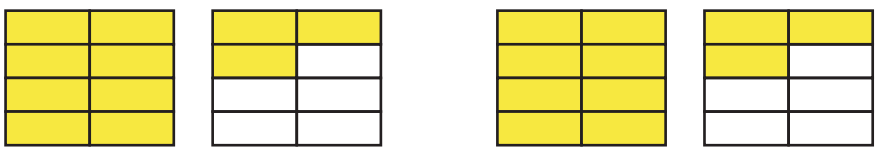

$\frac{8}{8} + \frac{3}{8} = 1 + \frac{3}{8} = 1\frac{3}{8}$