Shapes

Which pieces can be used to complete the shapes on the left?







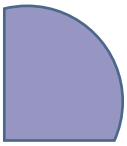


















Shapes

Which pieces can be used to complete the shapes on the left?

