3D Shapes

Which 3D shape do you see? Write its name.

(cone, sphere, cube, rectangular cuboid, pyramid, cylinder)

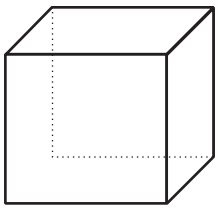

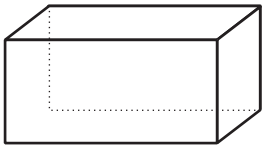



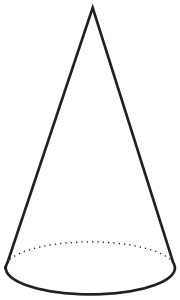



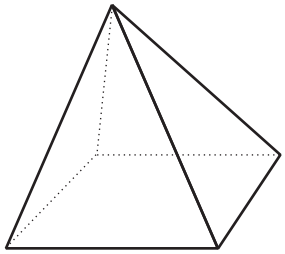

Write down the number of faces for each 3D shape.

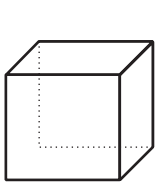

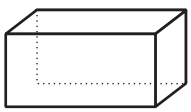





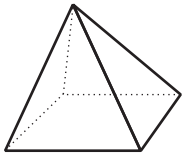



faces faces faces faces faces faces

3D Shapes

Which 3D shape do you see? Write its name.

(cone, sphere, cube, rectangular cuboid, pyramid, cylinder)

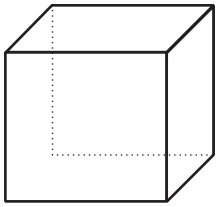

cube

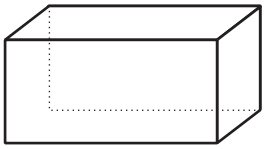

rectangular prism



sphere

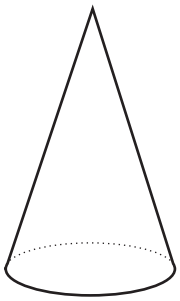

cone



cylinder

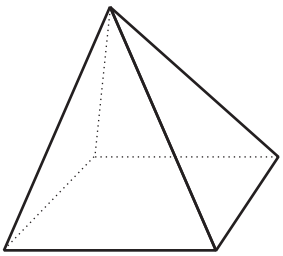

pyramid

Write down the number of faces for each 3D shape.

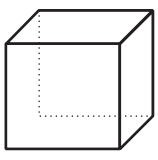

6 faces

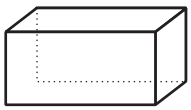

6 faces



3 faces



1 faces

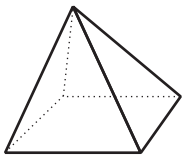

5 faces



2 faces