Estimating and Comparing Weights

Kilograms or tonnes? Estimate the weight and write the correct unit.



12 kg



200 _____



30 _____



25 _____



830 _____



2 _____



35 _____



4 _____

Order the weights from lightest to heaviest.

56 kg	8 t	380 g	6 kg 250 g	1 t 35 kg
380 g <	<	<	<	<

1 t 10 kg	51 kg 20 g	990 g	1000 kg	12 kg
<	<	<	<	<

150 g	6 kg 5 g	2 t	890 kg	890 g
<	<	<	<	<

Math Online School

Estimating and Comparing Weights

Kilograms or tonnes? Estimate the weight and write the correct unit.



12 kg



200 t



30 kg



25 t



830 kg



2 t



35 kg



4 t

Order the weights from lightest to heaviest.

56 kg	8 t	380 g	6 kg 250 g	1 t 35 kg
380 g	< 6 kg 250 g	< 56 kg	< 1 t 35 kg	< 8 t

1 t 10 kg	51 kg 20 g	990 g	1000 kg	12 kg
990 g	< 12 kg	< 51 kg 20 g	< 1000 kg	< 1 t 10 kg

150 g	6 kg 5 g	2 t	890 kg	890 g
150 g	< 890 g	< 6 kg 5 g	< 890 kg	< 2 t