Math Online School

Weights: Place Value Chart

Write each weight in the place-value chart. Then write it as a decimal number.



kilograms			grams		
H	T	O	H	T	O

kg and g _____

kg _____

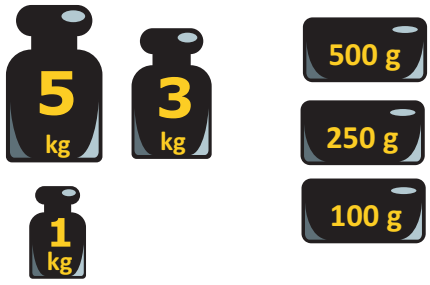

kilograms			grams		
H	T	O	H	T	O

kg and g _____

kg _____

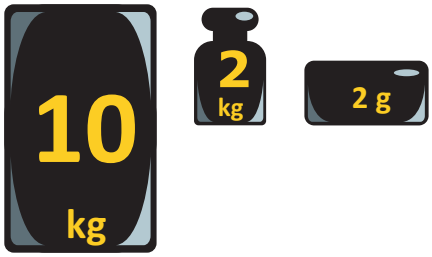

kilograms			grams		
H	T	O	H	T	O

kg and g _____

kg _____

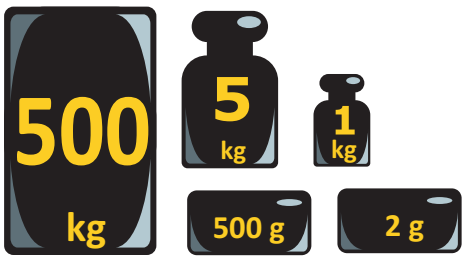

kilograms			grams		
H	T	O	H	T	O

kg and g _____

kg _____

Math Online School

Weights: Place Value Chart

Write each weight in the place-value chart. Then write it as a decimal number.



kilograms			grams		
H	T	O	H	T	O
1	0	5	0	1	5

kg and g: 105 kg 15 g

kg: 105.015 kg

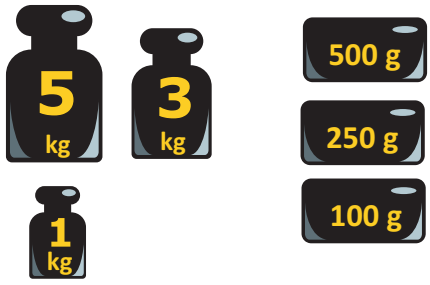

kilograms			grams		
H	T	O	H	T	O
		9	8	5	0

kg and g: 9 kg 850 g

kg: 9.85 kg

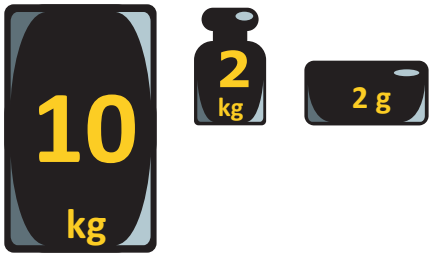

kilograms			grams		
H	T	O	H	T	O
	1	2	0	0	2

kg and g: 12 kg 2 g

kg: 12.002 kg

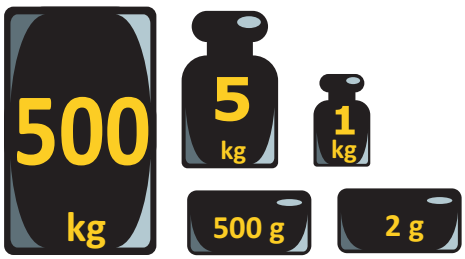

kilograms			grams		
H	T	O	H	T	O
5	0	6	5	0	2

kg and g: 506 kg 502 g

kg: 506.502 kg