Liquid Volume (L, mL)



Write "one liter," "a quarter of a liter," "half a liter," and "three-quarters of a liter" below the correct containers!

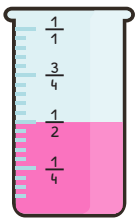

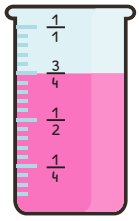

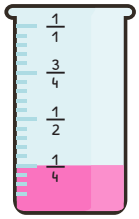

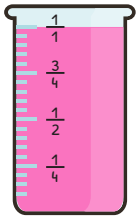

_____ _____ _____ _____

_____ _____ _____ _____

How many milliliters is that?

1 L = _____ mL

$\frac{3}{4}$ L = _____ mL

$\frac{1}{2}$ L = _____ mL

$\frac{1}{4}$ L = _____ mL

Match each container to its capacity.









30 mL

75 mL

250 mL

500 mL

1 L

12 L

30 L

120 L









Math Online School

Liquid Volume (L, mL)



Write "one liter," "a quarter of a liter," "half a liter," and "three-quarters of a liter" below the correct containers!

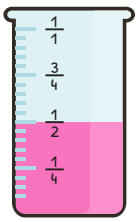

half a liter

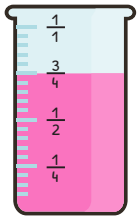

three-quarters of a liter

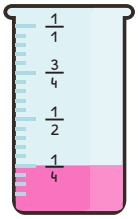

a quarter of a liter

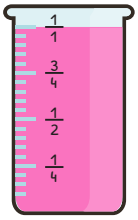

one liter

How many milliliters is that?

1 L = 1000 mL

3/4 L = 750 mL

1/2 L = 500 mL

1/4 L = 250 mL

Match each container to its capacity.

